Name: _____

Sr: 01062018-415

June 01, 2018

MATHS WORKSHEET GENERATOR 11-PLUS SATS GCSES

1) $(5 \times 7^8) + (2 \times 1^7)$

Answer: _____

2) Simplify 4:7

Answer: _____

3) $(1 \times 10^2) - (10 \times 8^3)$

Answer: _____

4) 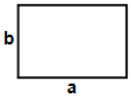

Find area of rectangle having sides a = 7 cm and b = 6 cm

Answer: _____

5) 05:01 am To 08:50 am

Answer: _____

6) 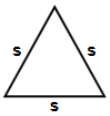

Find perimeter of triangle s = 1 in

Answer: _____

7) Simplify 8:2

Answer: _____

8) (-6) x (-5)

Answer: _____

9) 09:23 am To 12:28 pm

Answer: _____

10) 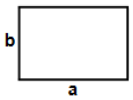

Find area of rectangle having sides a = 10 in and b = 9 in

Answer: _____

Total: ___ / 10

Copyright 2018 - Geek School Tutoring Limited